Name : _____ Score : _____

Teacher : _____ Date : _____

Identify the Type For Each Quadrilateral.

1) 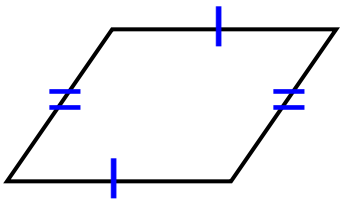

Type: _____

2) 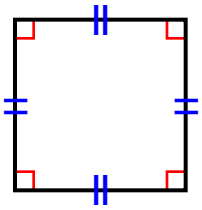

Type: _____

3) 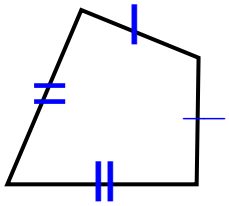

Type: _____

4) 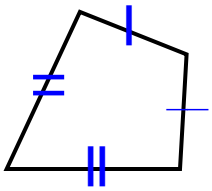

Type: _____

5) 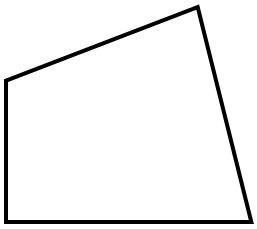

Type: _____

6) 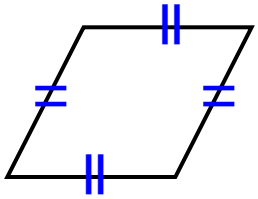

Type: _____

7) 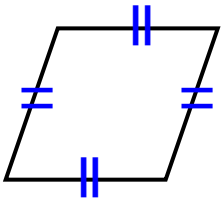

Type: _____

8) 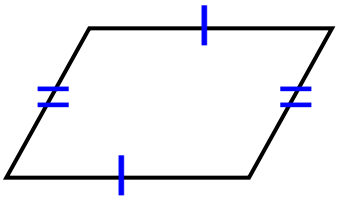

Type: _____

9) 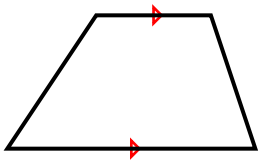

Type: _____

10) 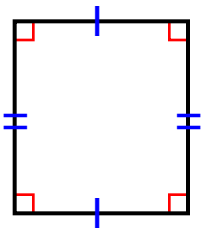

Type: _____

11) 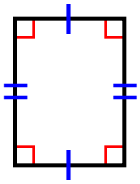

Type: _____

12) 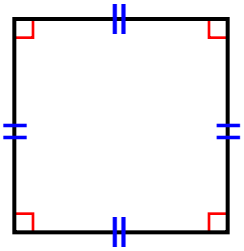

Type: _____

Math-Aids.Com

Name : _____ Score : _____

Teacher : _____ Date : _____

Identify the Type For Each Quadrilateral.

1) 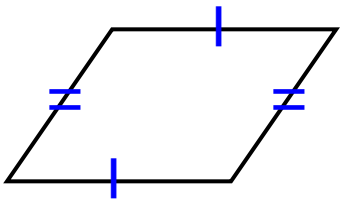

Type: Parallelogram

2) 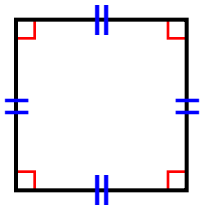

Type: Square

3) 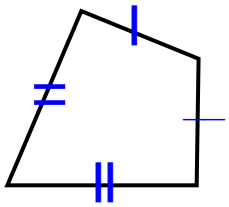

Type: Kite

4) 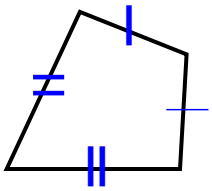

Type: Kite

5) 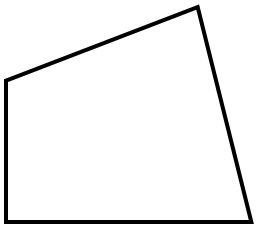

Type: Quadrilateral

6) 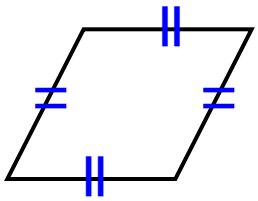

Type: Rhombus

7) 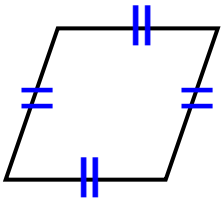

Type: Rhombus

8) 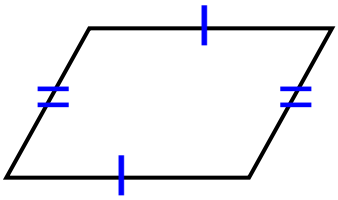

Type: Parallelogram

9) 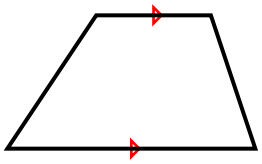

Type: Trapezoid

10) 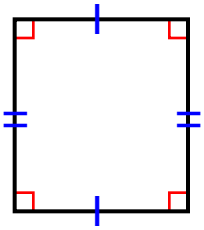

Type: Rectangle

11) 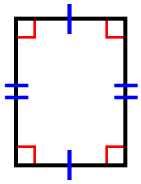

Type: Rectangle

12) 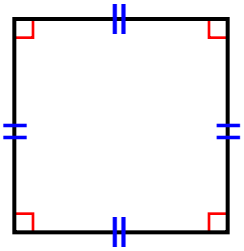

Type: Square

Math-Aids.Com