Name : _____ Score : _____

Teacher : _____ Date : _____

Classify each angle as acute, obtuse, right, or straight.

1 ) 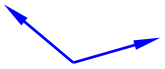 _____

2 ) _____

3 ) 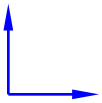 _____

4 ) _____

5 ) 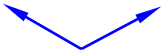 _____

6 ) _____

7 ) _____

8 ) _____

9 )  _____

10 ) _____

11 ) $154^{\circ}$ _____

12 ) $49^{\circ}$ _____

13 ) $59^{\circ}$ _____

14 ) $77^{\circ}$ _____

15 ) $144^{\circ}$ _____

16 ) $180^{\circ}$ _____

17 ) $90^{\circ}$ _____

18 ) $155^{\circ}$ _____

19 ) $111^{\circ}$ _____

20 ) $41^{\circ}$ _____

Math-Aids.Com

Name : _____ Score : _____

Teacher : _____ Date : _____

Classify each angle as acute, obtuse, right, or straight.

1 ) 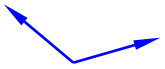 Obtuse

2 ) Obtuse

3 ) 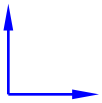 Right

4 ) Acute

5 ) 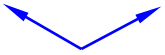 Obtuse

6 ) Obtuse

7 ) Acute

8 ) Straight

9 )  Acute

10 ) Acute

11 ) $154^{o}$ Obtuse

12 ) $49^{o}$ Acute

13 ) $59^{o}$ Acute

14 ) $77^{o}$ Acute

15 ) $144^{o}$ Obtuse

16 ) $180^{o}$ Straight

17 ) $90^{o}$ Right

18 ) $155^{o}$ Obtuse

19 ) $111^{o}$ Obtuse

20 ) $41^{o}$ Acute

Math-Aids.Com